DAS KLEINE EINMALEINS

2er Reihe

Name: _____





©www.tortugasinsel.ch

2er Reihe

Von der Plus- zur Malrechnung. Rechne aus.

2 + 2 + 2 + 2 + 2 = ___

5 • 2 = ___

2 + 2 + 2 = ___

3 • 2 = ___



2 + 2 = ___

2 • 2 = ___

2 + 2 + 2 + 2 + 2 + 2 = ___

6 • 2 = ___

2 + 2 + 2 + 2 + 2 + 2 + 2 = ___

7 • 2 = ___

Markiere alle Zahlen der 2er Reihe.

1	2	3	4	5	6	7	8	9	10
11	12	13	14	15	16	17	18	19	20

2er Reihe

Schreibe die 2er Reihe auf.

☐ ☐ ☐ ☐ ☐ ☐ ☐ ☐ ☐ ☐

Rechne.

4 · 2 = ___	3 · 2 = ___	5 · 2 = ___
1 · 2 = ___	6 · 2 = ___	10 · 2 = ___
8 · 2 = ___	9 · 2 = ___	2 · 2 = ___
2 · 2 = ___	7 · 2 = ___	9 · 2 = ___
5 · 2 = ___	10 · 2 = ___	3 · 2 = ___

2 · ☐ = 18
2 · ☐ = 20
2 · ☐ = 12
2 · ☐ = 2
2 · ☐ = 8
2 · ☐ = 6
2 · ☐ = 16
2 · ☐ = 4
2 · ☐ = 10
2 · ☐ = 14

Finde den Weg zum Schatz! Male alle Zahlen an, die in der 2er Reihe sind.

14	2	1	5	3
9	16	15	25	17
7	18	4	10	27
13	17	23	8	11
15	1	21	20	6



2er Reihe

Rechne und male.



rosa = 2 · ☐ = 18

braun = 2 · ☐ = 20

rot = 2 · ☐ = 12

grün = 2 · ☐ = 2

schwarz = 2 · ☐ = 10

gelb = 2 · ☐ = 6

hellbraun= 2 · ☐ = 14

orange = 2 · ☐ = 16

© www.tortugasinsel.ch
Schrift: Learn Thing, Quicksand
Bilder: pixabay.com, pangeran www.fotosearch.ch Stock Photography